O’clock and half past

1 Match the clocks to the times.



7 o’clock



3 o’clock



12 o’clock



10 o’clock

Complete the sentence.

At o’clock, the minute hand points to

2 Match the clocks to the times.



half past 4



half past 1



half past 9



half past 6

Complete the sentence.

At half past, the minute hand points to

© White Rose Maths 2020

3 Write the time shown on each clock.

Use the word bank to help you.

o'clock | half past

_____ _____

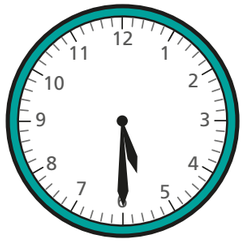

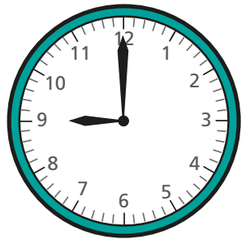

_____ _____

4 Draw hands to show the time on each clock.

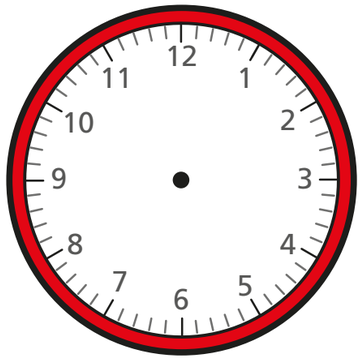

half past 11

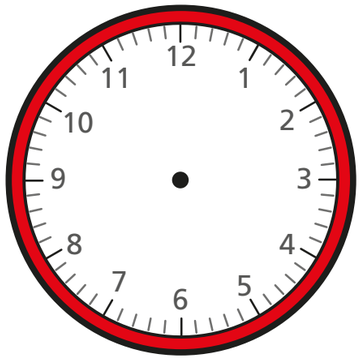

half past 3

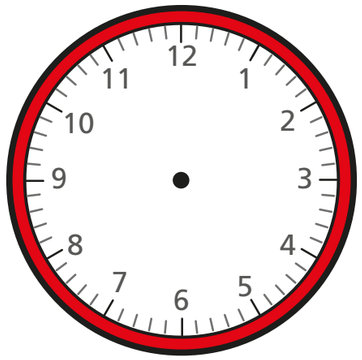

4 o'clock

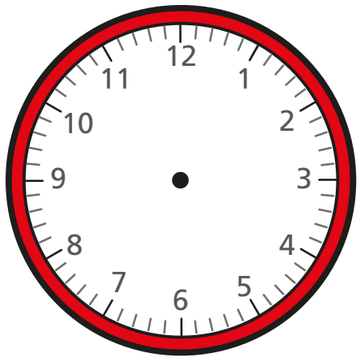

1 o'clock

5 Circle to show whether each sentence is true or false.

a) The clock shows 6 o'clock.

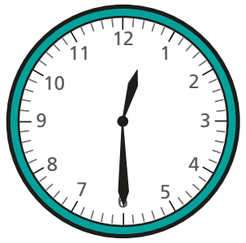

true **false**

b) The clock shows half past 10

true **false**

c) The clock shows half past 12

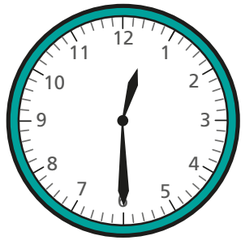

true **false**

Compare answers with a partner.

© White Rose Maths 2020