Fractions of a quantity

1 Complete the number sentences.

a) $\frac{1}{4}$ of 20 = 5

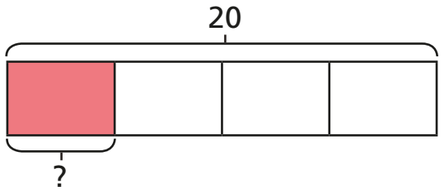

b) $\frac{1}{5}$ of 20 = 4

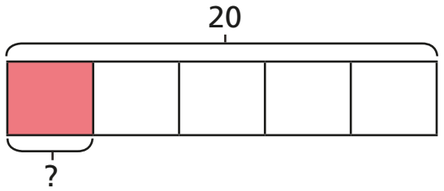

c) $\frac{1}{10}$ of 20 = 2

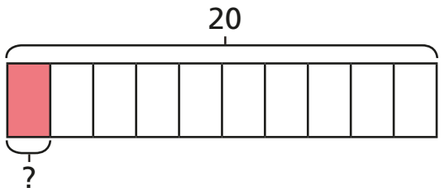

d) $\frac{1}{4}$ of 40 = 10

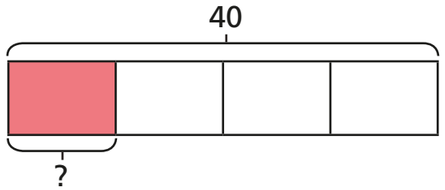

e) $\frac{1}{8}$ of 40 = 5

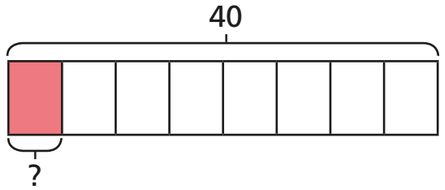

f) $\frac{1}{8}$ of 80 = 10

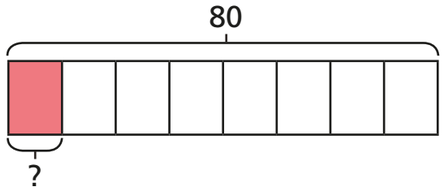

g) $\frac{1}{3}$ of 36 = 12

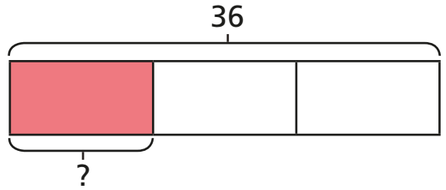

h) $\frac{1}{6}$ of 36 = 6

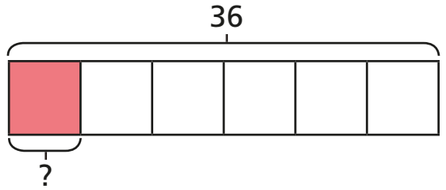

2 Filip has a chocolate bar with 5 equal pieces.

The chocolate bar weighs 60 g.

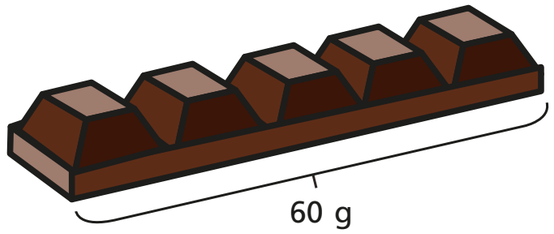

a) What is the mass of one piece?

The mass of one piece is 12 g.

b) Filip eats $\frac{3}{5}$ of the bar of chocolate.

How many grams does Filip eat?

Filip eats 36 g of chocolate.

© White Rose Maths 2019

3 Complete the number sentences.

a) $\frac{1}{4}$ of 24 = 6

$\frac{3}{4}$ of 24 = 18

b) $\frac{1}{7}$ of 35 = 5

$\frac{3}{7}$ of 35 = 15

$\frac{5}{7}$ of 35 = 25

c) $\frac{1}{8}$ of 32 = 4

$\frac{5}{8}$ of 32 = 20

d) $\frac{5}{8}$ of 64 = 40

$\frac{7}{8}$ of 64 = 56

$\frac{10}{8}$ of 64 = 80

4 Match the calculations to the answers.

$\frac{2}{3}$ of 18	18
$\frac{5}{6}$ of 18	15
$\frac{9}{10}$ of 20	16
$\frac{4}{5}$ of 20	12

5 a) Write each calculation in the correct circle.

$\frac{1}{2}$ of 16 $\frac{1}{4}$ of 24 $\frac{2}{3}$ of 9 $\frac{3}{2}$ of 4 $\frac{1}{6}$ of 48

= 6

$\frac{1}{4}$ of 24

$\frac{2}{3}$ of 9

$\frac{3}{2}$ of 4

= 8

$\frac{1}{2}$ of 16

$\frac{1}{6}$ of 48

b) Write one more calculation in each circle.

6 Write <, > or = to compare the calculations.

a) $\frac{2}{7}$ of 21 < $\frac{2}{3}$ of 21

b) $\frac{3}{5}$ of 40 = $\frac{2}{3}$ of 36

c) $\frac{6}{8}$ of 40 = $\frac{3}{4}$ of 40

d) $\frac{6}{10}$ of 50 = $\frac{3}{10}$ of 100

© White Rose Maths 2019