The 2 times-table

1 Write a fact from the 2 times-table to match the picture.

a)

5 × 2 = 10

b)

7 × 2 = 14

c)



4 × £2 = £8

2 **a)** Complete the number line.

b) Which times-table does the number line show?

Tick your answer.

1 times-table 2 times-table ✓

3 times-table

How do you know?

3 Complete the array and times-table fact so that they match.

a)



2 × 2 = 4

b)



2 × 5 = 10

c)



2 × 4 = 8

© White Rose Maths 2019

4 Complete the number sentences.

a) 3 × 2 = 6

b) 18 = 9 × 2

c) 2 × 5 = 10

d) 2 × 2 = 4

e) 12 = 6 × 2

f) 24 = 12 × 2

g) 2 × 1 = 2

h) 2 × 0 = 0

i) 14 = 2 × 7

j) 11 × 2 = 22

5 Teddy has £8

Rosie has twice as much money as Teddy.

How much money does Rosie have?

Rosie has £ 16

6 Eva is writing 10 × 2 in different ways.

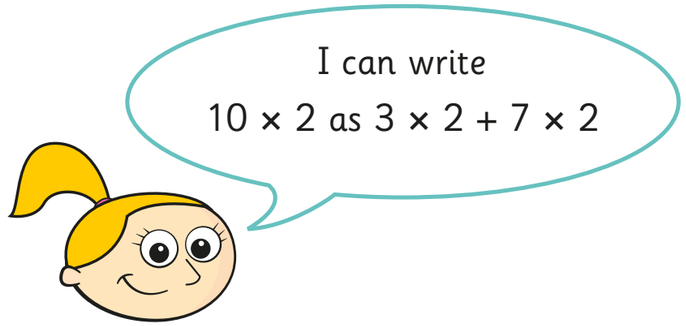



Find three more ways that you can write 10 × 2

Use counters to help you.

1 × 2 + 9 × 2

2 × 2 + 8 × 2

4 × 2 + 6 × 2

Compare answers with a partner.

© White Rose Maths 2019